Find this and other free resources at https://maktaba.tetea.org

WIZARA YA ELIMU NA MAFUNZO YA UFUNDI

MTIHANI WA TAIFA WA DARASA LA NNE - 2008

SOMO LA HISABATI

051

JINA LA MTAHINIWA: .....

JINA LA SHULE: .....

HALMASHAURI: .....

MKOA: .....

MUDA: Saa 1.15

MAELEKEZO:

1. Mtihani huu una maswali 25.
2. Jibu maswali yote kama ilivyoelekezwa.
3. Majibu yote yaandikwe katika karatasi za mtihani huu.
4. Kumbuka kuandika Jina lako, Jina la Shule, Halmashauri na Mkoa.
5. Simu za Mkononi na Kikokotoo haviruhusiwi kwenye chumba cha mitihani.

Find this and other free educational resources at:
https://maktaba.tetea.org

Scanned with CamScanner

Find this and other free resources at https://maktaba.tetea

JIBU MASWALI YAFUATAYO

Na.	SWALI	SEHEMU YA KAZI	JIBU
1.	466 + 134		
2.	784 - 225		
3.	137 + 293 + 25 =		
4.	18076 - 8181 =		
5.	785 x 13		
6.	903 ÷ 3 =		
7.	$\frac{5}{7}$ + $\frac{1}{7}$ =		
8.	$\frac{3}{4}$ - $\frac{2}{4}$ =		
9.	Andika elfu moja na mia tisa na moja kwa tarakimu		
10.	Sh.110 st. 80 + sh. 68 st 10 =		
11.	Andika XXXIX kwa tarakimu za kawaida		
12.	Saa 5 + 4 Dakika 38 + 50		
13.	Badili mita 4 kuwa sentimita		
14.	Uso wa saa ufuatao unaonesha saa ngapi? 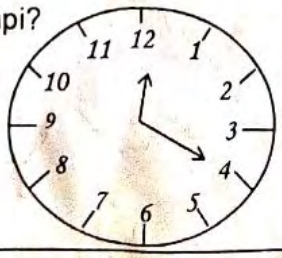		

Find this and other free educational resources at:
https://maktaba.tetea.org
Scanned with CamScanner

Find this and other free resources at: https://maktaba.tetea.org

Na.	SWALI	SEHEMU YA KAZI	JIBU
15.	Katika umbo lifuatalo, eneo lililotiwa kivuli ni sehemu gani ya umbo lote? 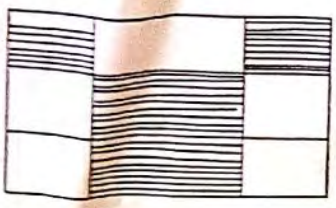		
16.	Chora kipande cha mstari $\overline{AB}$		
17.	Umbo lina pande nne sawa, kila upande ni sm 4. Tafuta mzingo.		
18.	Tafuta eneo la umbo lifuatalo: 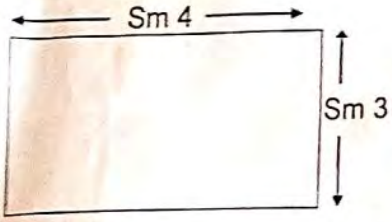		
19.	Mkungu wa ndizi unazo ndizi 135, iwapo kuna wanunuzi 5 wakigawana sawasawa, Kila mmoja atapa ndizi ngapi?		
20.	Bei ya kununulia kitabu kimoja cha Hisabati ni sh. 3,600. Je wanafunzi 4 watalipa jumla ya shilingi ngapi ikiwa kila mmoja atanunua kitabu kimoja?		
21.	Chagua herufi ya jibu sahihi. Vipimo vipi kati ya hivi vifuatavyo hutumika kupima uzani? A. Kilogramu, gramu na uzito B. Kilogramu, gramu na mizani C. Kilogramu na gramu		

Find this and other free educational resources at: https://maktaba.tetea.org
Scanned with CamScanner

Find this and other free resources at https://maktaba.tetea

Na.	SWALI	SEHEMU YA KAZI	JIBU
22.	Katika sehemu zifuatazo ni herufi ipi inawakilisha theluthi mbili? A: $\frac{2}{6}$ B: $\frac{2}{2}$ C: $\frac{2}{3}$		
23.	Rehema alinunua maboksi 5 ya chaki @ sh. 3,500, vitabu 6 @ sh. 320, penseli 40 @ sh. 40 na rula 2 @ sh. 200. Je alitumia kiasi gani cha fedha?		
	Mihimili ya grafu ifuatayo inaonesha mahudhurio ya wanafunzi wa darasa la nne lenye wanafunzi 120 kwa siku 5. Soma kwa makini na jibu swali la 24 na 25 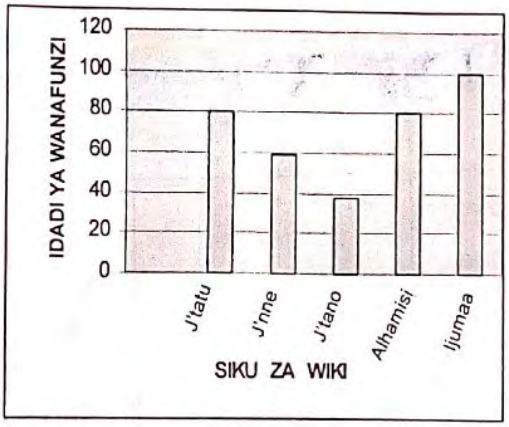 		
24.	Ni wanafunzi wangapi hawakuhudhuria darasani siku ya Jumatano?		
25.	Ni siku ngapi katika wiki mahudhurio yalikuwa sawa?		

Find this and other free educational resources at:
https://maktaba.tetea.org
Scanned with CamScanner